1. Izračunaj opseg pravokutnika.

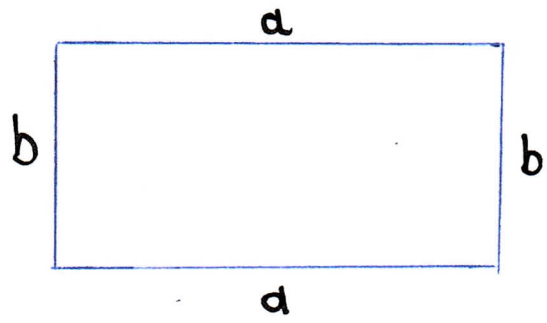

$O = 2 \cdot a + 2 \cdot b$

2. Izračunaj opseg zadanog geometrijskog lika.



3. Izračunaj opseg pravokutnika.